1. Tgei diembers ein marcai cun in paliet?

a

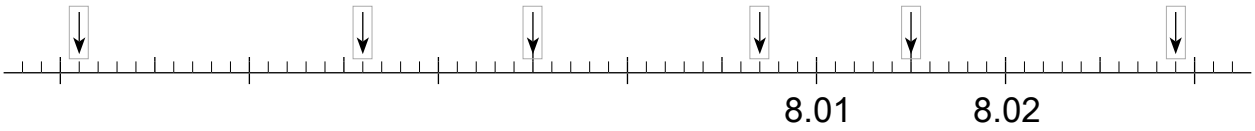

b

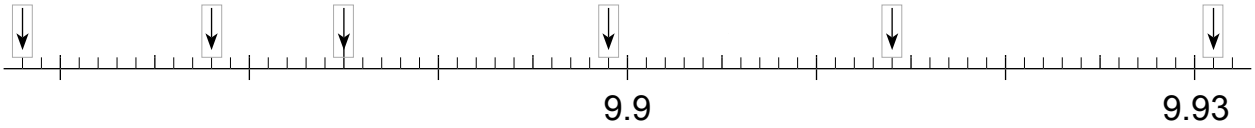

2. Noda la posiziun dils diembers cun paliats. Noda ils paliats.

a 0.095, 0.115, 0.078, 0.137, 0.104, 0.08

b 99.958, 100.01, 99.97, 99.995, 100.001, 100.021

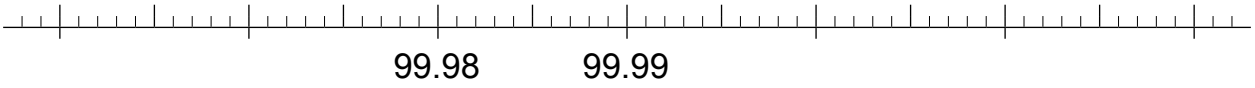

3. Dumbra cun pass anavon ed anavos. Cumpletescha culs diembers che mauncan.

a

b

© 2016 Lehrmittelverlag Zürich, ab Adobe Reader XI veränderbar